1. 다음 도형은 단위넓이의 몇 배입니까?

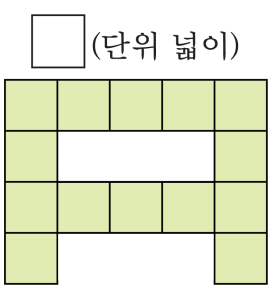

답: _____ 배

2. 가로가 18 cm 이고, 세로가 20 cm 인 직사각형의 넓이는 몇 cm^2 인지 구하시오.

답: _____ cm^2

3. 아래 평행사변형의 넓이를 구하시오.

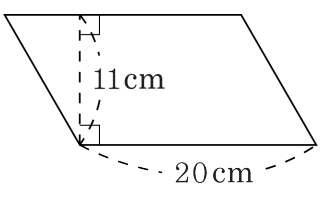

답: _____ cm^2

4. 다음 평행사변형의 넓이를 구하시오.

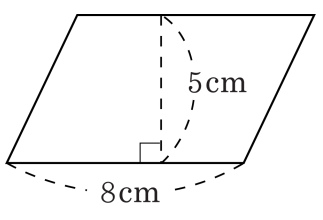

답: _____ cm^2

5. 다음 평행사변형의 넓이를 구하시오.

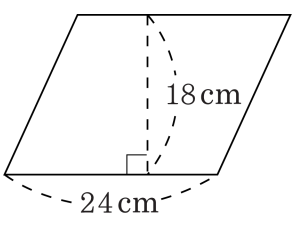

답: _____ cm^2

6. 평행사변형의 넓이를 구하시오.

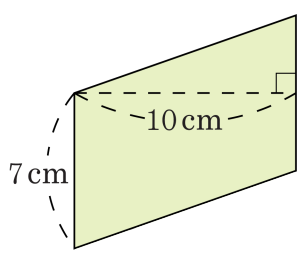

답: _____ cm^2

7. 다음 중 넓이가 다른 삼각형은 어느 것입니까?

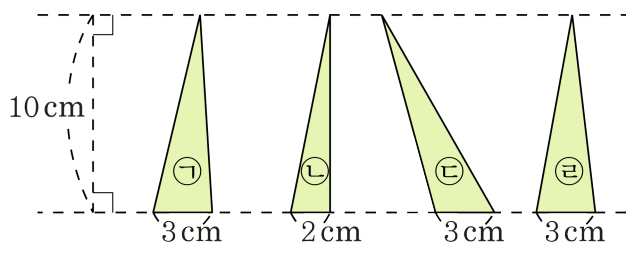

답: _____

8. 다음 삼각형의 넓이를 구하시오.

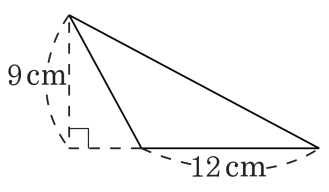

답: _____ cm^2

9. 다음 삼각형의 넓이를 구하시오.

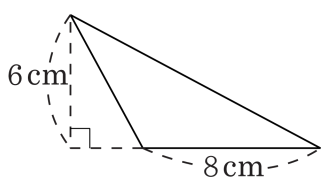

답: _____ cm^2

10. 삼각형의 넓이를 구하시오.

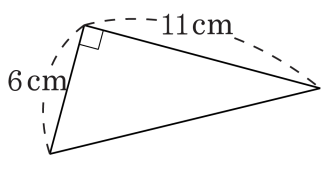

답: _____ cm^2

11. 색칠한 도형의 넓이를 구하시오.

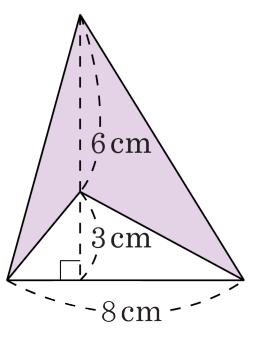

답: _____ cm^2

12. 색칠한 도형의 넓이를 구하시오.

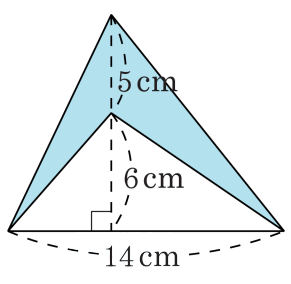

답: _____ cm^2

13. 색칠한 도형의 넓이를 구하시오.

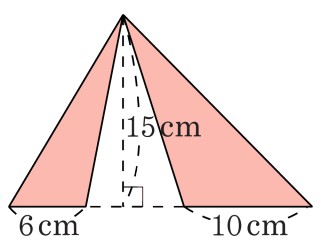

답: _____ cm^2

14. 변 ㄱㄷ이 밑변일 때, 삼각형 ㄱㄴㄷ의 높이는 어느 것인가?

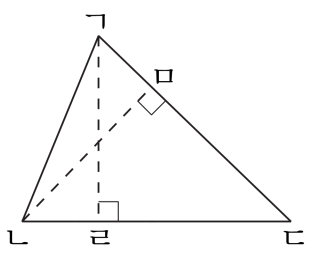

① 선분 ㄱㄹ ② 변 ㄱㄴ ③ 변 ㄴㄷ
④ 선분 ㄴㅁ ⑤ 변 ㄹㄷ

15. 다음 삼각형에서 $\square$ 안에 알맞은 수를 써넣으시오.

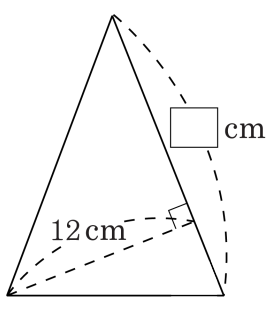

넓이 : $108\,cm^2$

답: _____

16. 다음 삼각형에서 $\square$ 안에 알맞은 수를 써넣으시오.

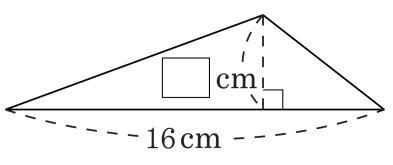

넓이 : $32\,\text{cm}^2$

답: _____

17. 가로 65cm , 세로 22cm 인 직사각형 모양의 땅의 넓이는 몇 cm^2 인가?

답: _____ cm^2

18. $\square$ 안에 알맞은 수를 써넣으시오.

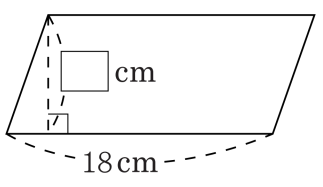

넓이 : $144\,\mathrm{cm}^2$

답: _____

19. 다음 평행사변형의 넓이가 $30\,\mathrm{cm}^2$ 일 때 $\square$ 안에 알맞은 수를 써넣으시오.

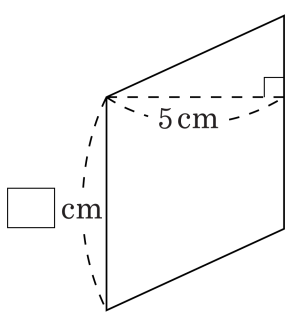

답: _____ cm

20. $\square$ 안에 알맞은 수를 써넣으시오.

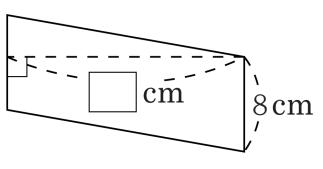

넓이 : $160\,\text{cm}^2$

답: _____ cm

21. 높이가 9 cm 인 평행사변형의 밑변의 길이는 몇 cm 입니까?

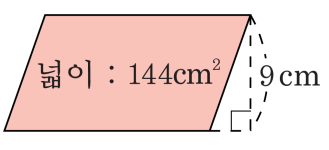

답: _____ cm

22. 다음 평행사변형의 높이는 몇 cm 입니까?

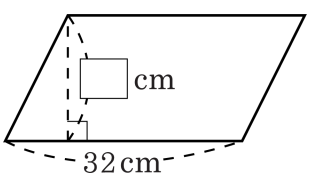

넓이 : $544\,\mathrm{cm}^2$

답: _____ cm

23. 넓이가 195cm^2 인 평행사변형이 있습니다. 이 평행사변형의 높이가 13cm 라면, 밑변의 길이는 몇 cm 입니까?

답: _____ cm

24. 둘레의 길이가 각각 36 cm 와 68 cm 인 정사각형이 있습니다. 두 정사각형의 한 변의 길이의 차는 얼마입니까?

① 4 cm ② 5 cm ③ 6 cm ④ 7 cm ⑤ 8 cm

25. 다음 도형은 직사각형 2개를 붙여 놓은 것입니다. 도형 전체의 넓이가 1134cm^2 일 때, 이 도형의 둘레의 길이를 구하시오.

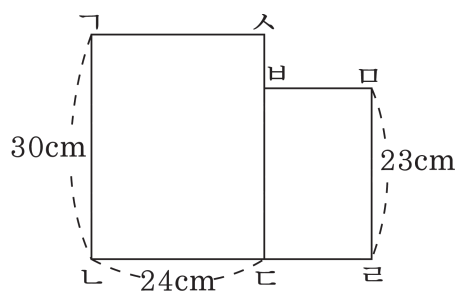

답: _____ cm

26. 다음 도형은 직사각형 2개를 붙여 놓은 것입니다. 도형 전체의 넓이가 $492\,\mathrm{cm}^2$ 일 때, 이 도형의 둘레의 길이를 구하시오.

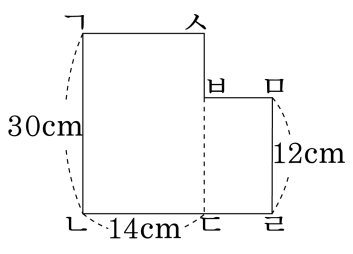

답: _____ cm

27. 다음 색칠한 부분의 넓이는 몇 cm^2 입니까?

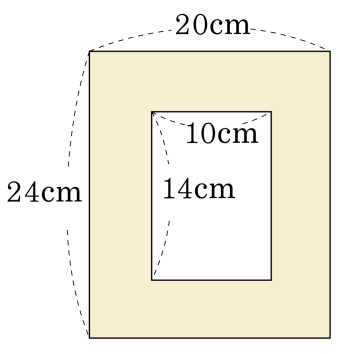

① $140cm^2$ ② $200cm^2$ ③ $280cm^2$
④ $340cm^2$ ⑤ $480cm^2$

28. 도형의 색칠한 부분의 넓이를 구하시오.

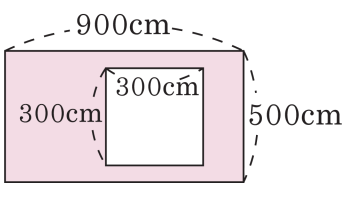

답: _____ cm^2

29. 도형의 색칠한 부분의 넓이를 구하시오.

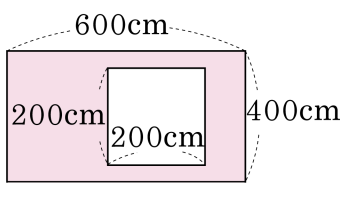

답: _____ cm^2

30. 색칠한 부분의 넓이를 구하시오.

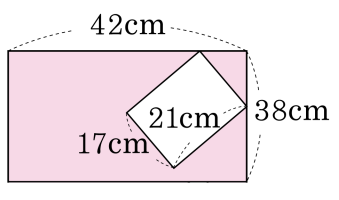

답: _____ cm^2